Soru 1:

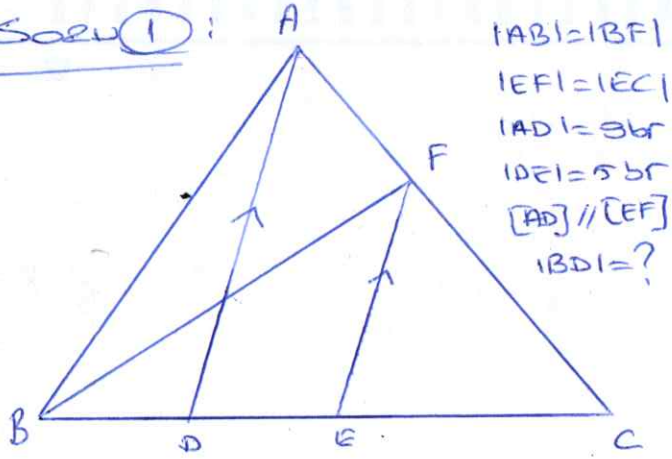

$|AB| = |BF|$

$|EF| = |EC|$

$|AD| = 9$ br

$|DE| = 5$ br

$[AD] // [EF]$

$|BD| = ?$

Soru 2:

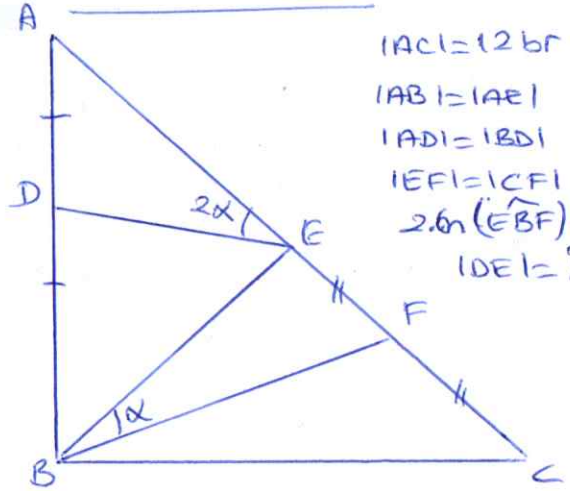

$|AC| = 12$ br

$|AB| = |AE|$

$|AD| = |BD|$

$|EF| = |CF|$

$2.m(\widehat{EBF}) = m(\widehat{AED})$

$|DE| = ?$

Soru 3:

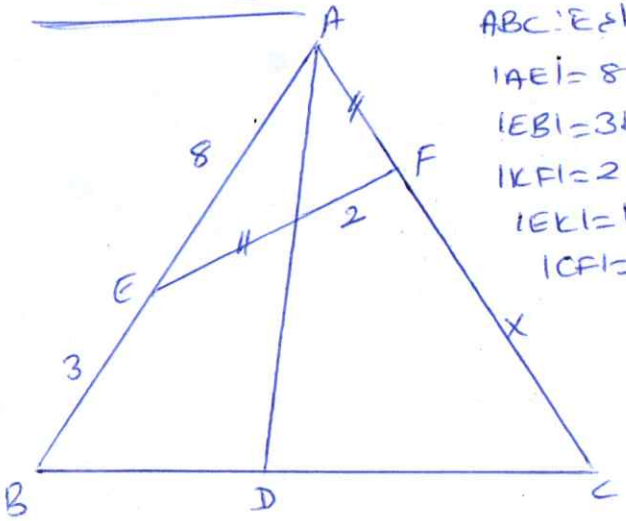

ABC: Eşkenar üçgen.

$|AE| = 8$ br

$|EB| = 3$ br

$|KF| = 2$ br

$|EK| = |AF|$

$|CF| = x = ?$

Soru 4:

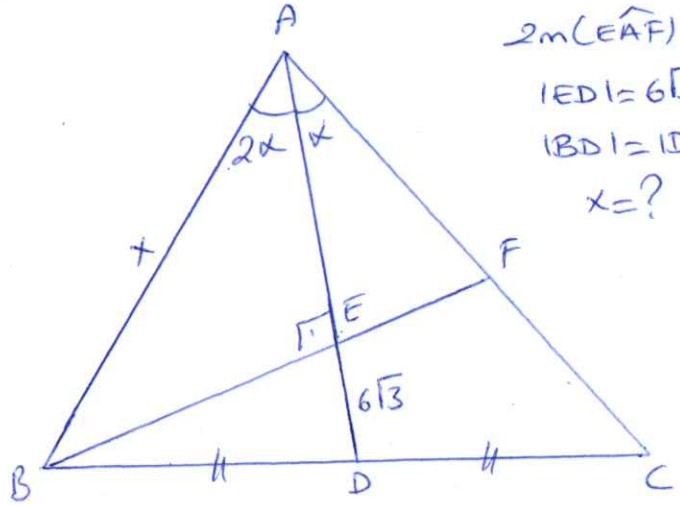

$2m(\widehat{EAF}) = m(\widehat{BAE})$

$|ED| = 6\sqrt{3}$

$|BD| = |DC|$

$x = ?$